Name _____ Date _____

More or Fewer?

Count each group. Circle the one that is asked for.

Circle the group that has MORE.











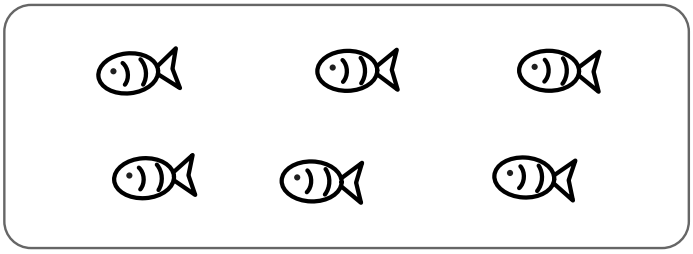

Circle the group that has FEWER.





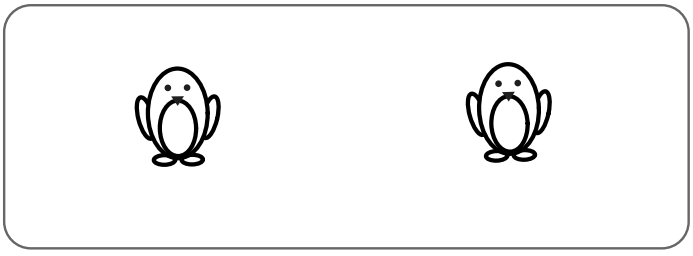







Free for Personal & Classroom Use | www.oyepaglu.com