Name _____ Date _____

Count Pennies, Nickels and Dimes

Count by 10s, then 5s, then 1s. Write the total in cents.

1. 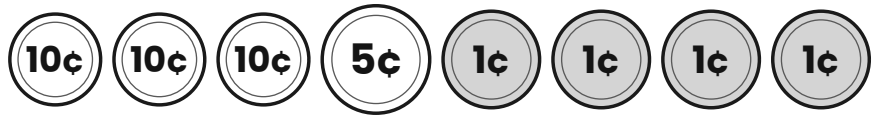

Total: ¢

2. 

Total: ¢

3. 

Total: ¢

4. 

Total: ¢

5. 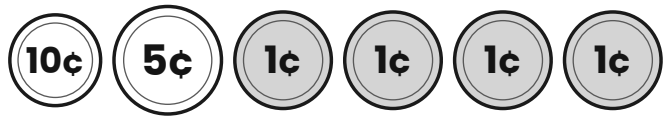

Total: ¢

6. 

Total: ¢

7. 

Total: ¢

8. 

Total: ¢

Free for Personal & Classroom Use | www.oyepaglu.com