Name _____ Date _____

Draw the Hands on the Clock

Draw the short hour hand and the long minute hand to show each time.

1. 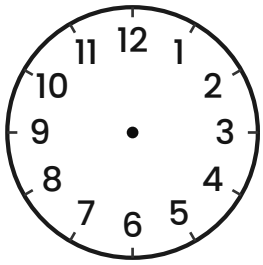

5:45

2. 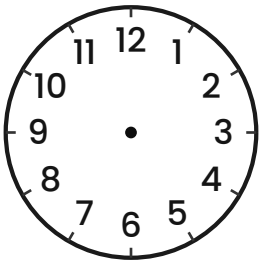

4:30

3. 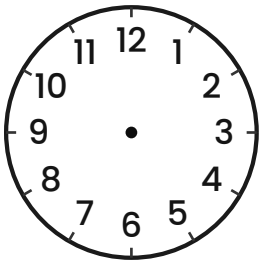

4:55

4. 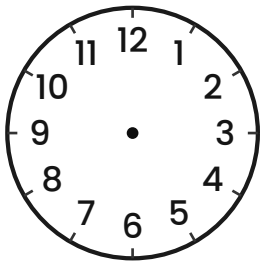

2:30

5. 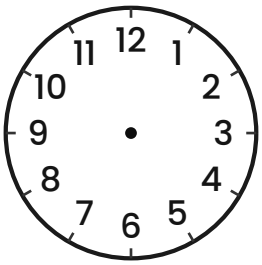

8:20

6. 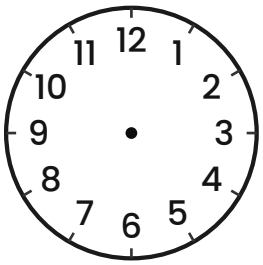

10:30

7. 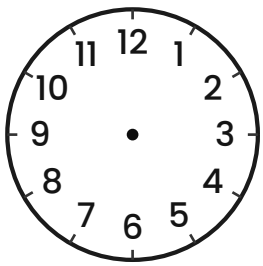

3:20

8. 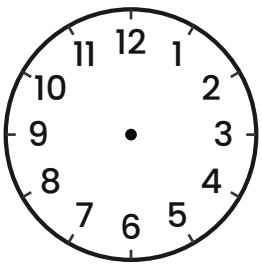

11:35

9. 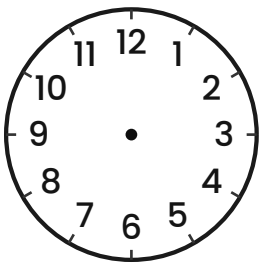

9:00

10. 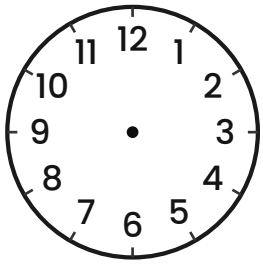

5:00

11. 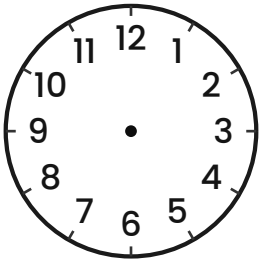

8:15

12. 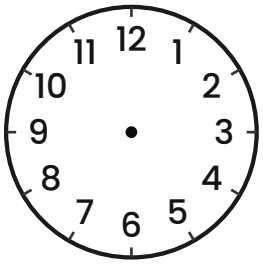

4:20

Free for Personal & Classroom Use | www.oyepaglu.com