Name _____ Date _____

Telling Time to the Minute

Count the small marks for the minutes. Write each time.

1. 

:

2. 

:

3. 

:

4. 

:

5. 

:

6. 

:

7. 

:

8. 

:

9. 

:

10. 

:

11. 

:

12. 

:

Free for Personal & Classroom Use | www.oyepaglu.com